THE VILLAGE
INTERNATIONAL SCHOOL
"We Nurture Dreams"

CPE-1 (2022-23)-JULY

MATHEMATICS

Date: 11/06/2022 **Total marks: 20**

Grade : V **Time : 1 hour**

General Instructions:

- This question paper consists of two sections, **A** and **B**.
- Section A comprises of **10** questions of **1** mark each.
- Section B comprises of **2** questions of **2** marks each and **2** questions of **3** marks each.
- All questions are compulsory.

Sl. No	SECTION A - OBJECTIVE TYPE	MARKS
	MULTIPLE CHOICE QUESTIONS	
1	A geometrical shape which has only one end-point is called ……. a) line segment b) line c) ray d) none of them	1
2	Identify the type of angle given below. 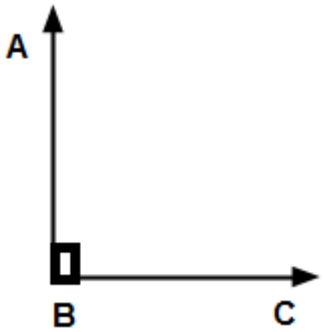 a) acute angle b) right angle c) obtuse angle d) straight angle	1

3	Choose the obtuse angle from the given figures, 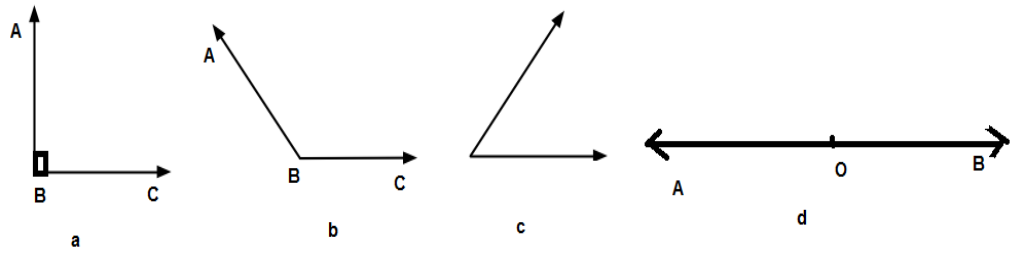 a) fig. a b) fig. b c) fig. c d) fig. d	1
4	Write the number; **Ten thousand two hundred five.** a) 10205 b) 102005 c) 10 250 d) 102005	1
5	100 less than 14,865 is, a) 13865 b) 14765 c) 14965 d)15865	1
	FILL IN THE BLANKS	
6	Angle which measures exactly 90 degree is called …….	1
7	Angle formed on a line is ……..	1
8	The successor of the biggest 4-digit number is……	1
	Write: TRUE /FALSE	
9	The angle measure depends on the length of the arms.	1
10	The predecessor of 10,000 is 9,999.	1
	SECTION B – SUBJECTIVE TYPE	
11	i)Measure the angle given below.	2

	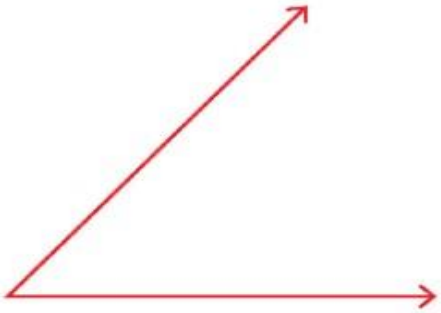 ii) What type of angle is it?	
12	When a line intersects or touches another line as shown, two angles are formed. Measure each angle. Find the sum of the angles? 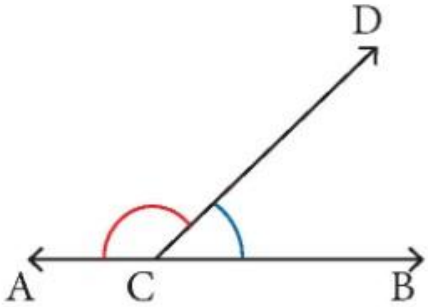 <ACD =..... <BCD = ……. <ACD + <BCD = ….. + ……. = ……	2
13	Construct an angle of 80 degree.	3
14	i) Write 78,952 in words. ii)Write the following numbers in ascending order. 5864, 1486, 8941, 4378	1 2

Prepared by: Mr. Shammy Divakar&Ms. Sruthy S Kumar Checked by: Ms. Jimmy Joseph